Tiervenner

1. klasse · To tal, der giver 10 tilsammen



Navn: _____

Eksempel



7 + 3 = 10

7 røde og 3 blå prikker fylder tierrammen. 7 og 3 er **tiervenner**.

Øv dig

Tierrammen skal være fuld. Hvor mange blå prikker mangler?

1 2 + ____ = 10



2 5 + ____ = 10



3 8 + ____ = 10



4 4 + ____ = 10



5 9 + ____ = 10



6 6 + ____ = 10



Tiervenner

Brug det og Udfordring



Navn: _____

Brug det

7 Mia har 6 æbler. Kurven har plads til 10. Hvor mange æbler mangler?

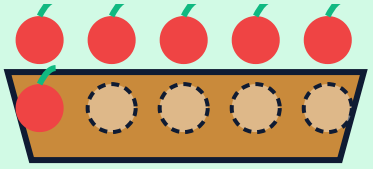

6 + ____ = 10

8 Find tiervennen:

Tal	3	9	5	0
Tierven				

9 Slik koster 10 kr. Du har 4 kr. Hvor mange kr mangler du?



4 + ____ = 10

10 Der er 10 p-pladser. 3 er optaget. Hvor mange er ledige?



3 + ____ = 10

Udfordring

11 Skriv tiervennen: **4 + ____ = 10** **____ + 8 = 10**

Skriv to par mere, der giver 10: **____ + ____** **____ + ____**

12 **Tiervenner til 20.** 15 + 5 = 20. Skriv resten:

12 + ____ = 20 **18 + ____ = 20**

13 **Trappe over 10.** 9 + 4: tag 1 fra 4, så 9 + 1 = 10, og 10 + 3 = 13.

Prøv selv: **8 + 5: 8 + ____ = 10, 10 + ____ = ____**